My Chess Family

Count the points: chess piece values worksheet

Free chess worksheets from mychessfamily.uk · Free to photocopy for teaching

Name: _____ **Ages 6–9**

Pawn 1, knight 3, bishop 3, rook 5, queen 9. Who is ahead? Circle the answer.

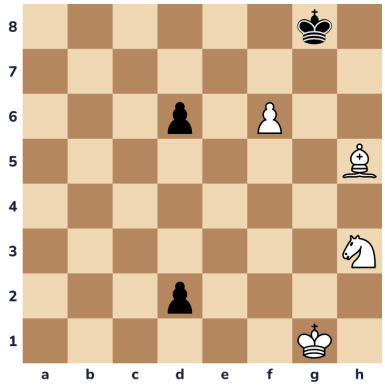

1. Count the points. Who is ahead?

A: Black, by 5 **B: White, by 5** **C: White, by 6**

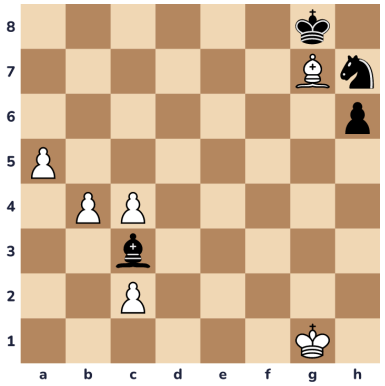

2. Count the points. Who is ahead?

A: Black, by 1 **B: Nobody** **C: White, by 1**

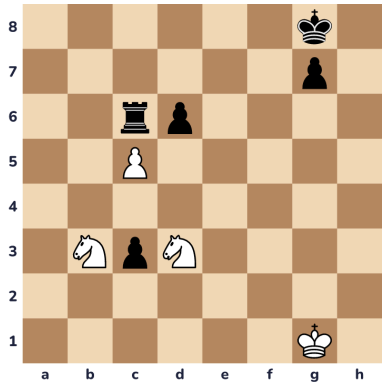

3. Count the points. Who is ahead?

A: Black, by 1 **B: Black, by 2** **C: White, by 1**

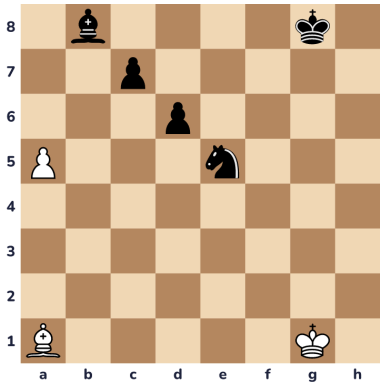

4. Count the points. Who is ahead?

A: Black, by 4 **B: Black, by 5** **C: White, by 4**

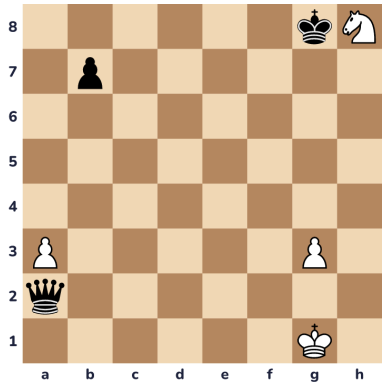

5. Count the points. Who is ahead?

A: Black, by 5 **B: Black, by 6** **C: White, by 5**

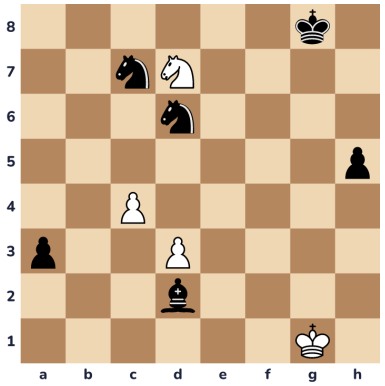

6. Count the points. Who is ahead?

A: Black, by 6 **B: Black, by 7** **C: White, by 6**

Answers

1. B: White, by 5

2. B: Nobody

3. A: Black, by 1

4. A: Black, by 4

5. A: Black, by 5

6. A: Black, by 6