My Chess Family

Where can the knight go? Knight moves worksheet

Free chess worksheets from mychessfamily.uk · Free to photocopy for teaching

Name: _____ **Ages 5–8**

Circle every square the knight can jump to. Count them!

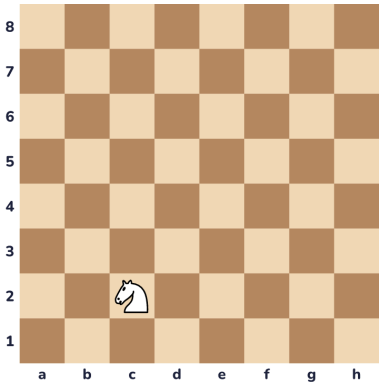

1. Circle every square the knight can move to.

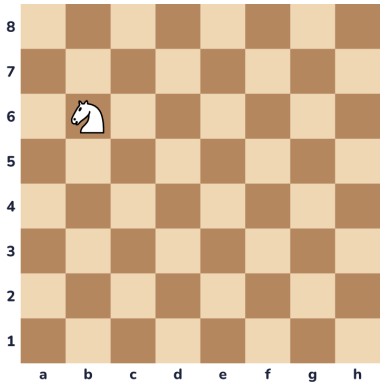

2. Circle every square the knight can move to.

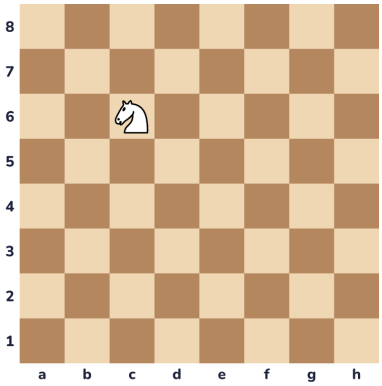

3. Circle every square the knight can move to.

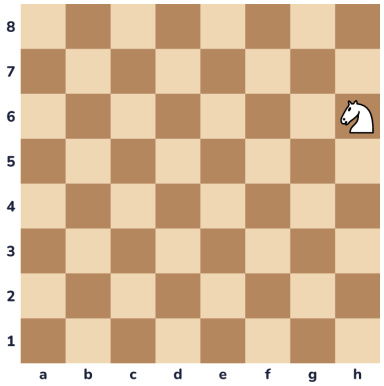

4. Circle every square the knight can move to.

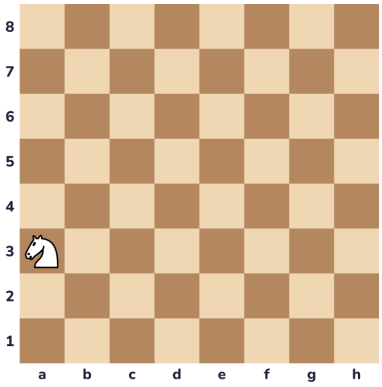

5. Circle every square the knight can move to.

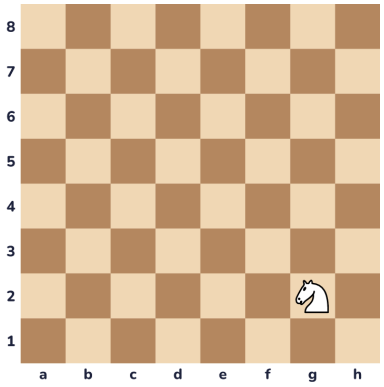

6. Circle every square the knight can move to.

Answers

1. a3, b4, d4, e3, e1, a1

The knight jumps in an L: two squares, then one to the side.

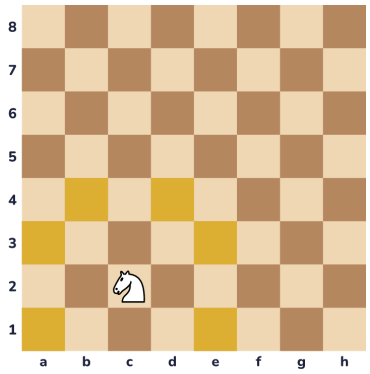

2. a8, c8, d7, d5, c4, a4

The knight jumps in an L: two squares, then one to the side.

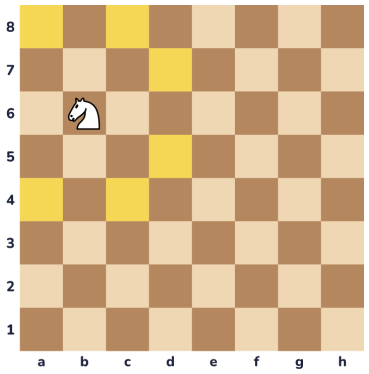

3. a7, b8, d8, e7, e5, d4, b4, a5

The knight jumps in an L: two squares, then one to the side.

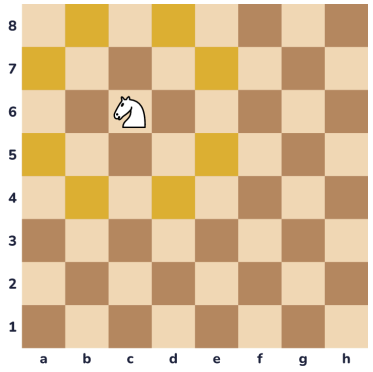

4. f7, g8, g4, f5

The knight jumps in an L: two squares, then one to the side.

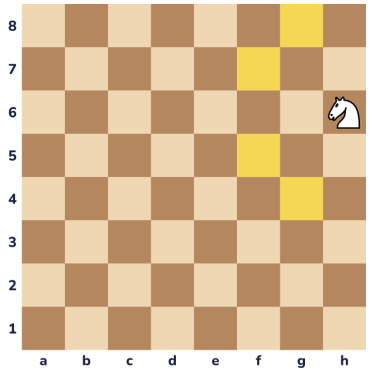

5. b5, c4, c2, b1

The knight jumps in an L: two squares, then one to the side.

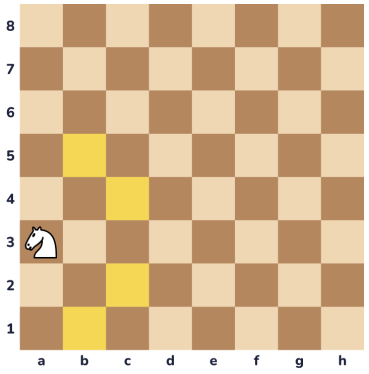

6. e3, f4, h4, e1

The knight jumps in an L: two squares, then one to the side.

